DOĞAL SAYILAR

Aşağıdaki çiftlikteki anne ve yavru tavukları sayalım.



Anne tavuklar : .....

Yavru tavuklar : .....

Aşağıdaki boşlukları dolduralım.

Yukarıda ..... kitap vardır.



Yukarıda ..... çiçek yaprağı vardır.



Yukarıda ..... yumurta vardır.



Yukarıda ..... balık vardır.

Yukarıda ..... top vardır.



Yukarıda ..... çilek vardır.